Name: mathe.sh Datum:

Brüche - Gleichnamige Brüche addieren und subtrahieren

1 Notiere die dargestellte Additionsaufgabe.

a) 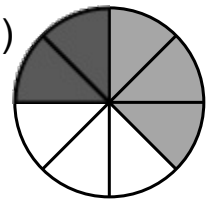

b) 

c)

d) 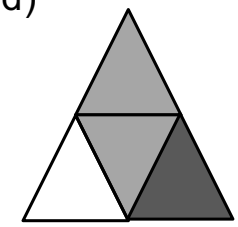

e) 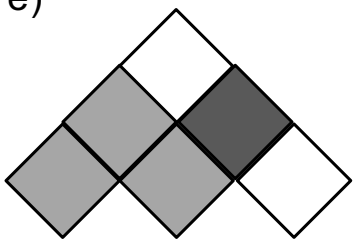

f) 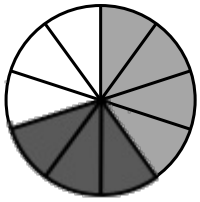

2 Notiere die dargestellte Subtraktionsaufgabe.

a)

b) 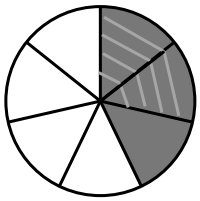

3 Berechne.

a) $\frac{3}{5} + \frac{1}{5} =$ b) $\frac{4}{9} + \frac{3}{9} =$ c) $\frac{2}{7} + \frac{4}{7} =$ d) $\frac{3}{8} + \frac{4}{8} =$

e) $\frac{8}{11} - \frac{5}{11} =$ f) $\frac{5}{6} - \frac{3}{6} =$ g) $\frac{9}{14} - \frac{5}{14} =$ h) $\frac{7}{10} - \frac{4}{10} =$